Measuring and Showing Data Name:

Measure each leaf tip to tip then place your results in the line plot.

Ex)



1)



2)

3)

4)



5)

6)

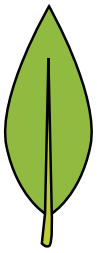

7)

8)

9)

10)

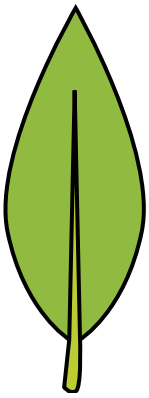

11)

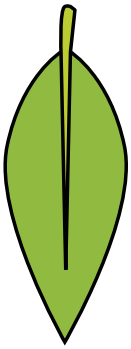

Line Plot							
$\frac{1}{4}$	$\frac{1}{2}$	$\frac{3}{4}$	1	$1\frac{1}{4}$	$1\frac{1}{2}$	$1\frac{3}{4}$	2

Answers

Ex. $1\frac{3}{4}$

1. _____
2. _____
3. _____
4. _____
5. _____
6. _____
7. _____
8. _____
9. _____
10. _____
11. _____

1-10	91	82	73	64	55	45	36	27	18	9
11	0									

Measuring and Showing Data

Name: **Answer Key**

Measure each leaf tip to tip then place your results in the line plot.

Ex)



1)



2)

3)

4)



5)

6)

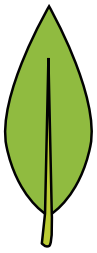

7)

8)

9)

10)

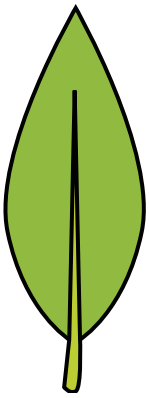

11)

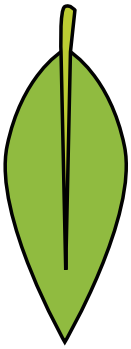

Line Plot

	X			X		X	X
X	X	X	X	X	X	X	X
$\frac{1}{4}$	$\frac{1}{2}$	$\frac{3}{4}$	1	$1\frac{1}{4}$	$1\frac{1}{2}$	$1\frac{3}{4}$	2

Answers

Ex.	$1\frac{3}{4}$
1.	2
2.	$\frac{1}{4}$
3.	1
4.	$1\frac{1}{2}$
5.	$\frac{1}{2}$
6.	$1\frac{1}{4}$
7.	$\frac{3}{4}$
8.	$1\frac{1}{4}$
9.	$\frac{1}{2}$
10.	2
11.	$1\frac{3}{4}$